Arrays: Rows and Columns

Name _____ Date _____ Score ____ / 9

Count the rows and the dots in each row. Then write how many dots there are in all.



Rows: ____
In each row: ____
In all: _____



Rows: ____
In each row: ____
In all: _____



Rows: ____
In each row: ____
In all: _____



Rows: ____
In each row: ____
In all: _____



Rows: ____
In each row: ____
In all: _____



Rows: ____
In each row: ____
In all: _____



Rows: ____
In each row: ____
In all: _____



Rows: ____
In each row: ____
In all: _____



Rows: ____
In each row: ____
In all: _____

Arrays: Rows and Columns — Answer Key

Name _____ Date _____ Score ____ / 9

Count the rows and the dots in each row. Then write how many dots there are in all.



Rows: **3**
In each row: **7**
In all: **21**



Rows: **5**
In each row: **4**
In all: **20**



Rows: **5**
In each row: **3**
In all: **15**



Rows: **2**
In each row: **6**
In all: **12**



Rows: **2**
In each row: **3**
In all: **6**



Rows: **3**
In each row: **5**
In all: **15**



Rows: **2**
In each row: **5**
In all: **10**



Rows: **4**
In each row: **4**
In all: **16**



Rows: **4**
In each row: **5**
In all: **20**