Arrays: Write the Multiplication Sentence

Name _____ Date _____ Score ____ / 9

Look at each array. Write the multiplication sentence: rows × dots in each row = total.



___ × ___ = ___



___ × ___ = ___



___ × ___ = ___



___ × ___ = ___



___ × ___ = ___



___ × ___ = ___



___ × ___ = ___



___ × ___ = ___



___ × ___ = ___

Arrays: Write the Multiplication Sentence — Answer Key

Name _____ Date _____ Score ____ / 9

Look at each array. Write the multiplication sentence: rows × dots in each row = total.



4 × 3 = 12



2 × 5 = 10



5 × 7 = 35



2 × 3 = 6



4 × 4 = 16



2 × 6 = 12



2 × 2 = 4



4 × 5 = 20



3 × 2 = 6